Name: _____ Date _____

Abe and George Choosing Products

Directions: Look at the numbers in the box. Choose two numbers that will complete each multiplication sentences.

5 7 4 10

1. ☐ x ☐ = 35



11 6 2 12

2. ☐ x ☐ = 66

Name: _____ Date _____



$\square \times \square = 72$

3.



$\square \times \square = 54$

4.

Tons of Free Math Worksheets at: © www.mathworksheetsland.com

Name: _____ Date _____

Abe and George Choosing Products

Answer key

Directions: Look at the numbers in the box. Choose two numbers that will complete each multiplication sentences.

5 7 4 10

1. 7 x 5 = 35



11 6 2 12

2. 11 x 6 = 66

Name: _____ Date _____



8	X	9	=	72

3.



6	X	9	=	54

4.