Name _____ Date _____

Visual Place Value: Ones, Tens, Hundreds Blocks Guided Lesson

Value Key:

= 1 = 10  = 100

Find the value of each group of base 10 blocks.

1) 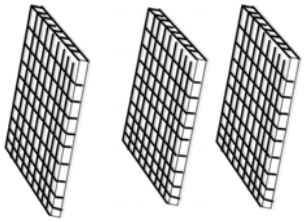 _____ hundreds 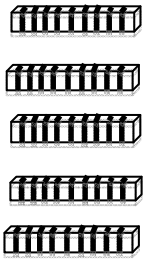 _____ tens _____ ones

_____ Total

2) 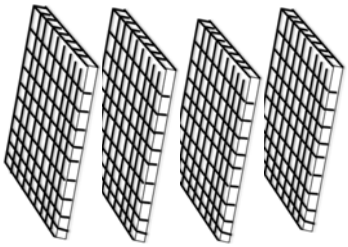 _____ hundreds 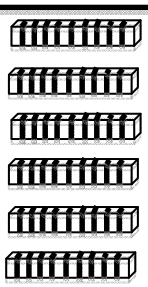 _____ tens _____ ones

_____ Total

3) 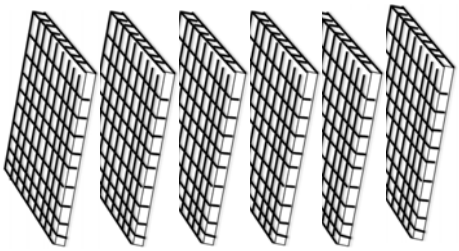 _____ hundreds _____ tens _____ ones

_____ Total

4) 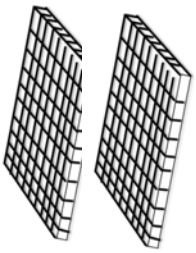 _____ hundreds  _____ tens _____ ones

_____ Total

Tons of Free Math Worksheets at: © www.MathWorksheetsLand.com